Circle the **pentagon** with exactly **four acute angles.**

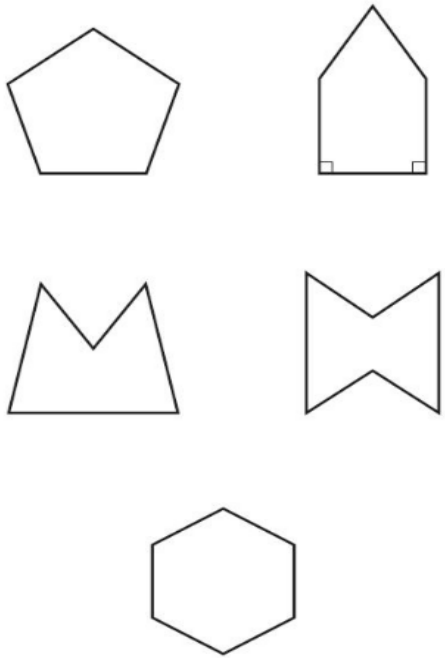

Here are five angles marked on a grid of squares.

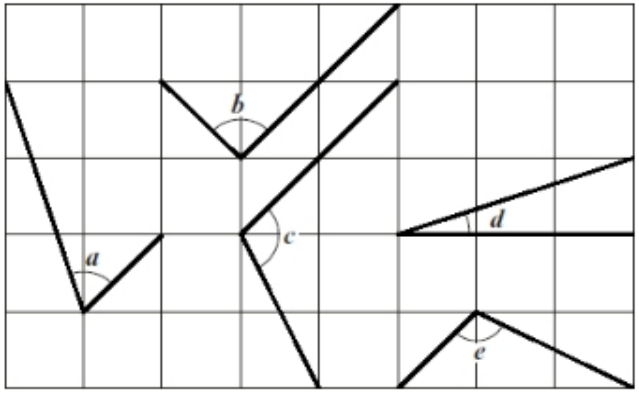

Write the letters of the angles that are **obtuse**.

_____ 1 mark

Write the letters of the angles that are **acute**.

_____ 1 mark

Join dots on the grid to make a quadrilateral that has 3 **acute** angles.

Two of the angles in a triangle are 70° and 40°

Jack says,

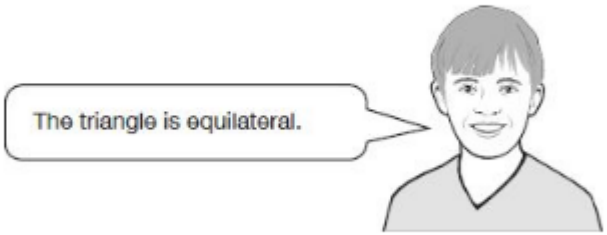

Explain why Jack is **not** correct.